Function Machines (Add & Subtract) Name:

**Determine the rule each function machine is using.**

**Ex)**

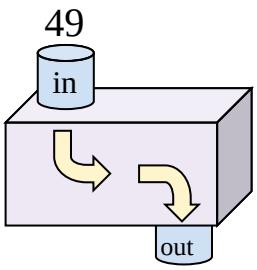


Subtract 21

**1)**

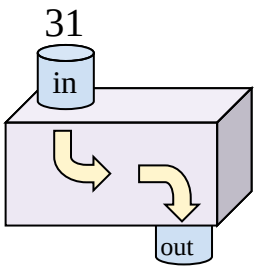


**2)**

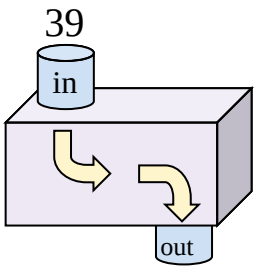


**3)**

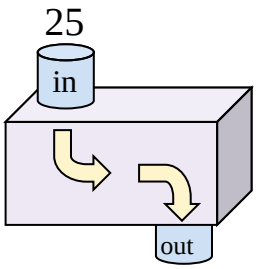


**4)**

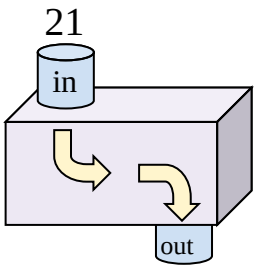


**5)**

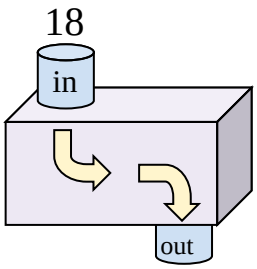


**6)**

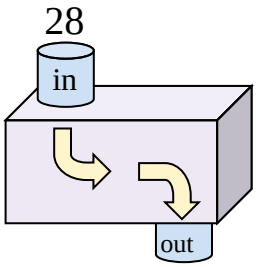


**7)**

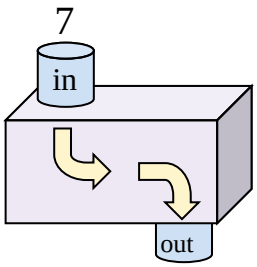


**8)**

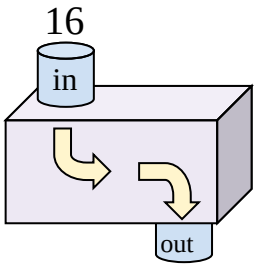


**9)**

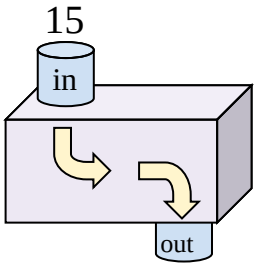


**10)**

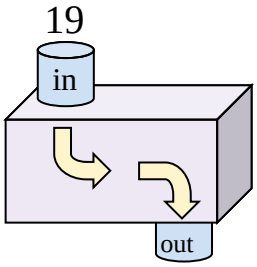


**11)**

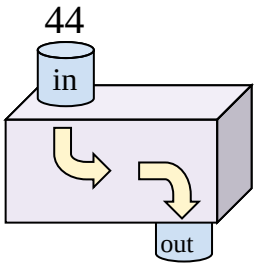


## Answers

Ex. Subtract 21

1. _____
2. _____
3. _____
4. _____
5. _____
6. _____
7. _____
8. _____
9. _____
10. _____
11. _____

Function Machines (Add & Subtract) Name: **Answer Key**

**Determine the rule each function machine is using.**

**Ex)**

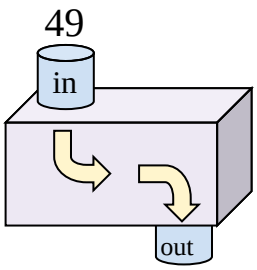


Subtract 21

**1)**

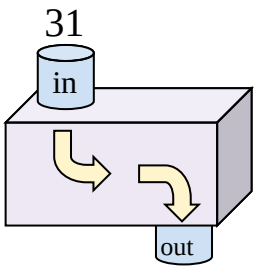


Subtract 7

**2)**

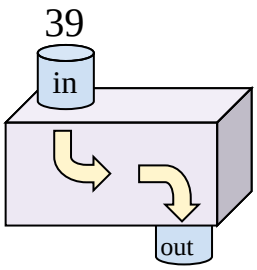


Subtract 18

**3)**

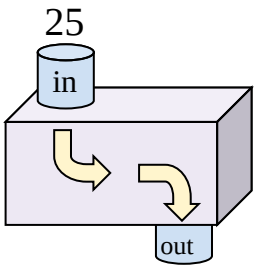


Subtract 17

**4)**

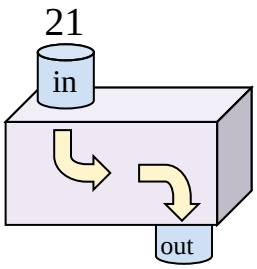


Add 16

**5)**

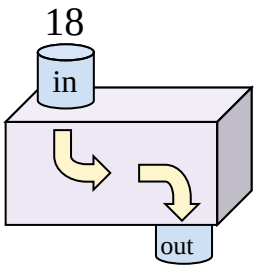


Add 25

**6)**

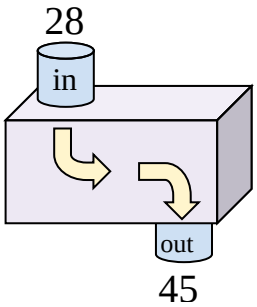


Add 17

**7)**

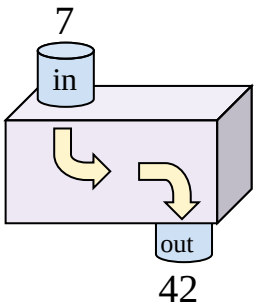


Add 35

**8)**

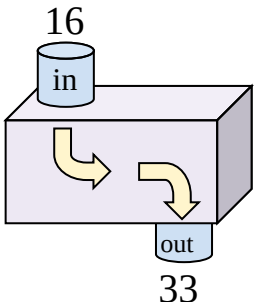


Add 17

**9)**

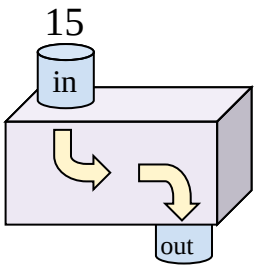


Add 12

**10)**

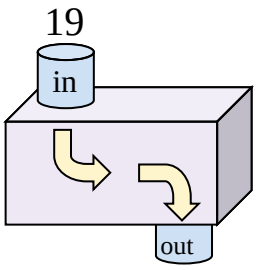


Add 13

**11)**

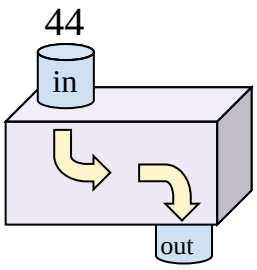


Subtract 15

## Answers

| | |
|---|---|
| Ex. | Subtract 21 |
| 1. | Subtract 7 |
| 2. | Subtract 18 |
| 3. | Subtract 17 |
| 4. | Add 16 |
| 5. | Add 25 |
| 6. | Add 17 |
| 7. | Add 35 |
| 8. | Add 17 |
| 9. | Add 12 |
| 10. | Add 13 |
| 11. | Subtract 15 |