Dividing with a Numberline

Name:

Use the numberline to solve each problem.

1) 14÷7=

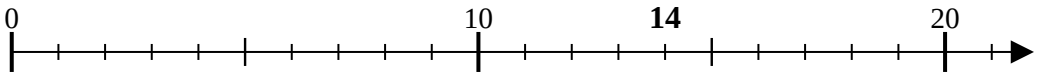

2) 12÷6=

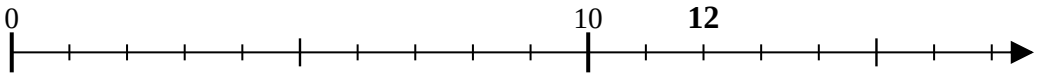

3) 15÷5=

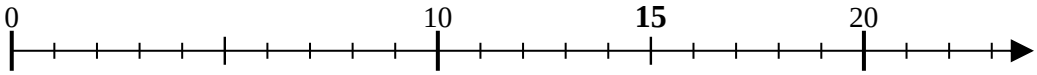

4) 12÷3=

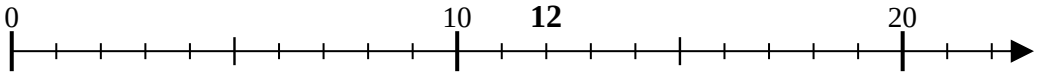

5) 10÷2=

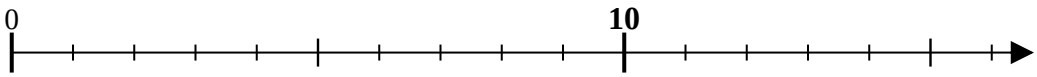

6) 20÷10=

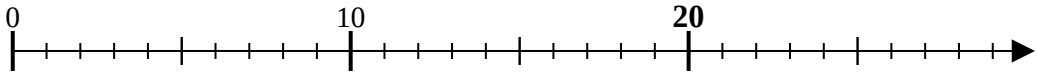

7) 18÷6=

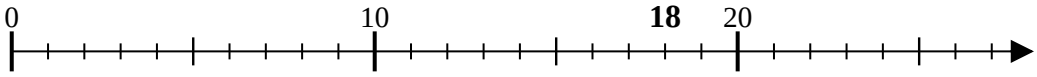

8) 30÷6=

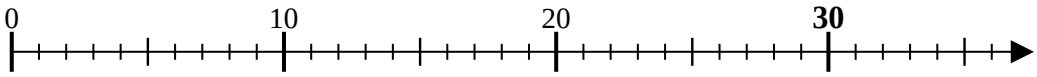

9) 12÷4=

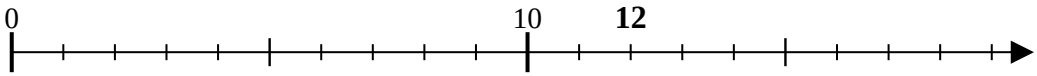

10) 24÷6=

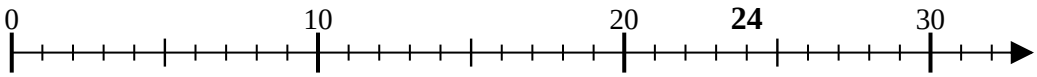

11) 30÷10=

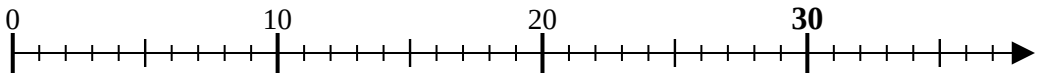

Answers

1. _____
2. _____
3. _____
4. _____
5. _____
6. _____
7. _____
8. _____
9. _____
10. _____
11. _____

1-10	91	82	73	64	55	45	36	27	18	9
11	0									

Dividing with a Numberline

Name: **Answer Key**

Use the numberline to solve each problem.

1) 14÷7=

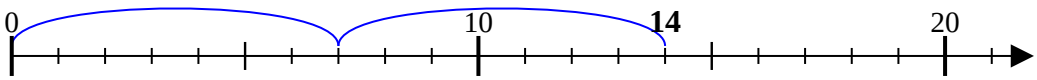

2) 12÷6=

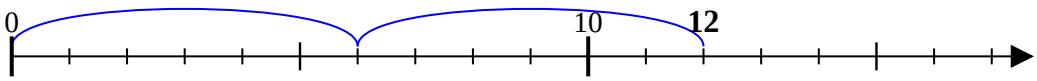

3) 15÷5=

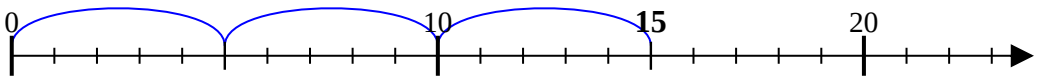

4) 12÷3=

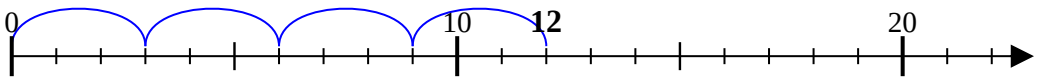

5) 10÷2=

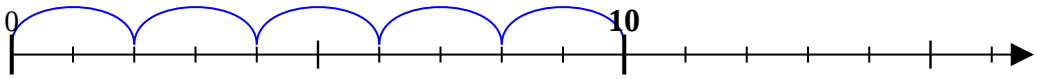

6) 20÷10=

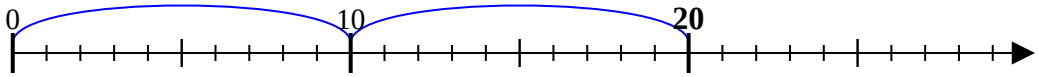

7) 18÷6=

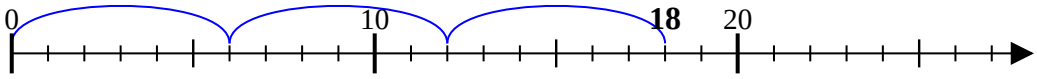

8) 30÷6=

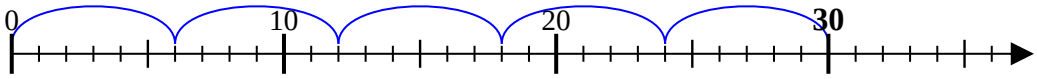

9) 12÷4=

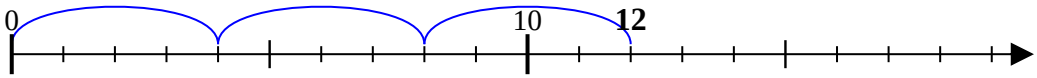

10) 24÷6=

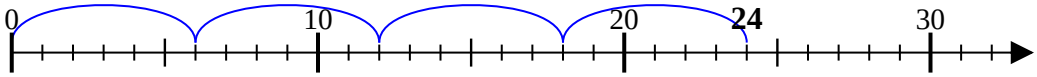

11) 30÷10=

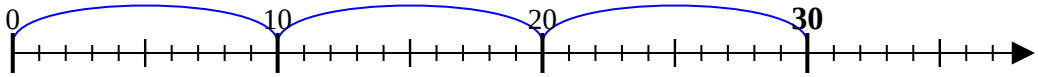

Answers

1. 2
2. 2
3. 3
4. 4
5. 5
6. 2
7. 3
8. 5
9. 3
10. 4
11. 3

1-10	91	82	73	64	55	45	36	27	18	9
11	0									