Dividing with a Numberline Name:

Use the numberline to solve each problem.

1) 6÷2=

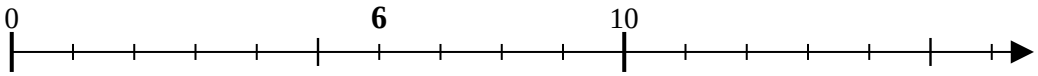

2) 18÷9=

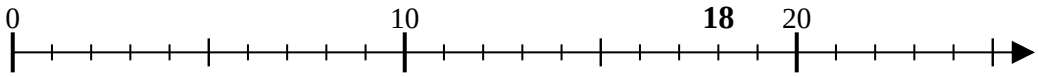

3) 28÷7=

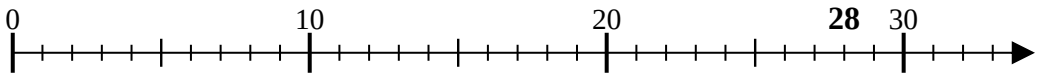

4) 45÷9=

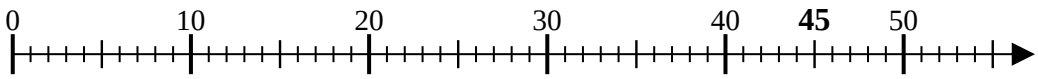

5) 8÷4=

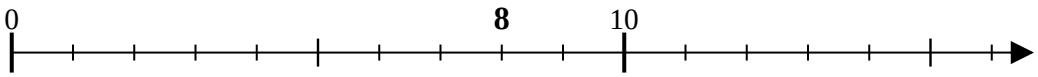

6) 30÷10=

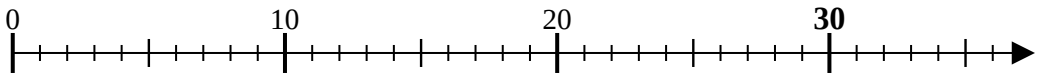

7) 14÷7=

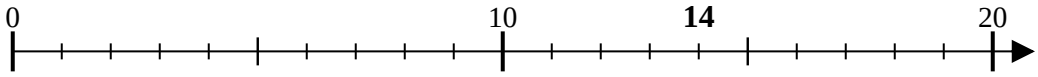

8) 16÷4=

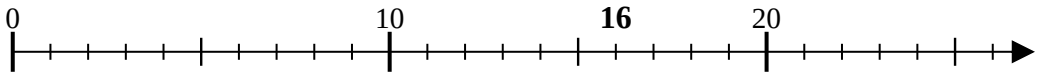

9) 15÷3=

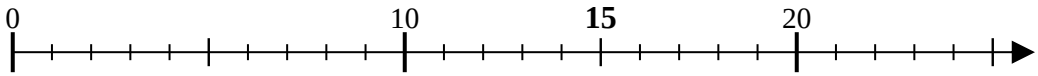

10) 12÷6=

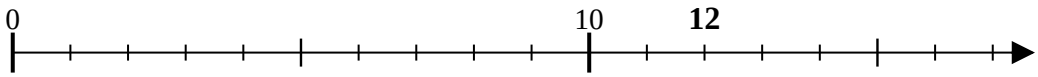

11) 25÷5=

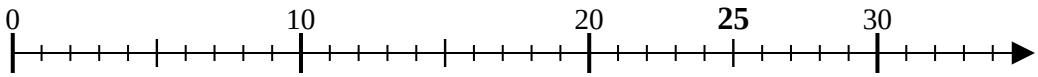

Answers

1. _____
2. _____
3. _____
4. _____
5. _____
6. _____
7. _____
8. _____
9. _____
10. _____
11. _____

1-10	91	82	73	64	55	45	36	27	18	9
11	0									

Dividing with a Numberline

Name: **Answer Key**

Use the numberline to solve each problem.

1) 6÷2=

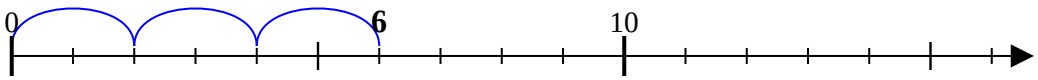

2) 18÷9=

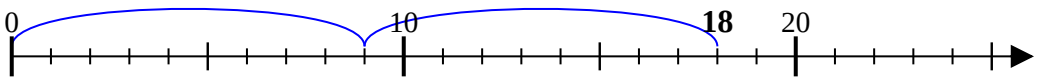

3) 28÷7=

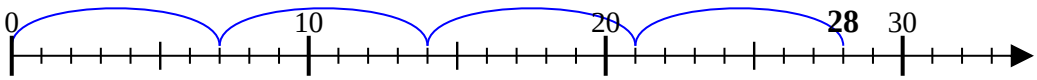

4) 45÷9=

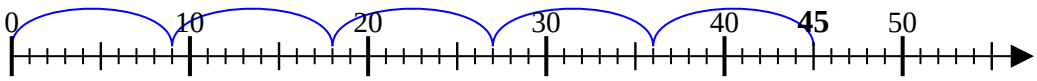

5) 8÷4=

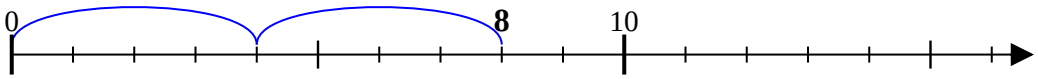

6) 30÷10=

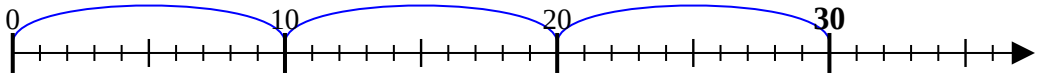

7) 14÷7=

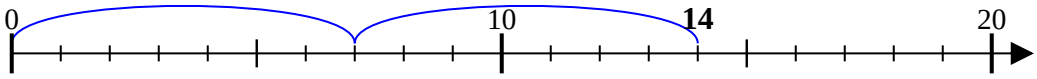

8) 16÷4=

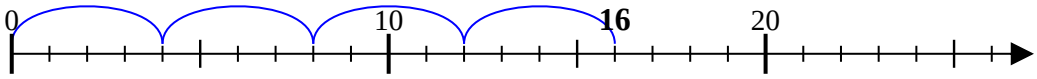

9) 15÷3=

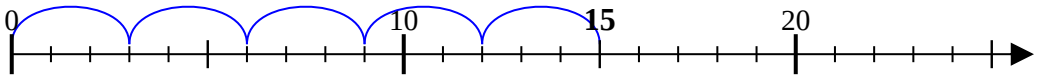

10) 12÷6=

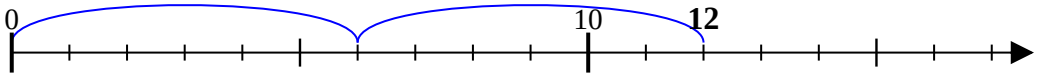

11) 25÷5=

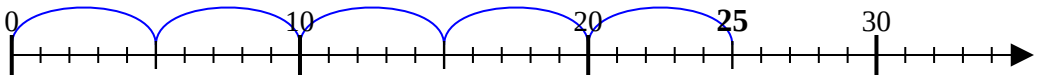

Answers

1. 3
2. 2
3. 4
4. 5
5. 2
6. 3
7. 2
8. 4
9. 5
10. 2
11. 5

1-10	91	82	73	64	55	45	36	27	18	9
11	0									